Name: _____

Mathematics – End of Term Examination

Read the instructions carefully. Answer the questions.

Section A – Sort the shapes into the correct column.

Flat Shapes	Solid Shapes

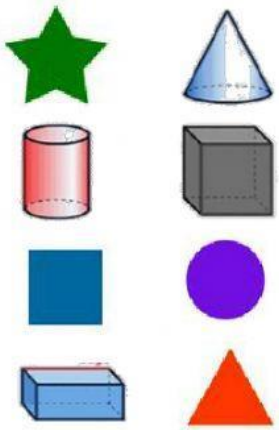

Section B – Patterns – Complete the patterns below.



Section C – Temperature and Mass - Choose the correct answer.

Which object is heavy?	Which object is light?
	
Choose the object that is cold.	**Choose the object that is hot.**
	

Section D – Length and height - Choose the correct answer.

Which object is short?	Which object is long? 
Which object is taller?	Which object is shortest?

Section E – Draw a line to connect the digit to the correct number word or tally mark.

Section A

- 6
- 3
- 1
- 8

Section B

- three
- 𝍸 III
- six
- I

Section F – Join the sets. Write the correct answer.

+ = _____	 + = _____
+ = _____	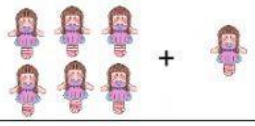 + = _____

Section G - Problem Solving – Read the problem, then solve.

- 2 ducks on a pond.

  3 ducks join them.

  How many ducks altogether?

  _____ + _____ = _____