Nyatakan jumlah wang berdasarkan rajah yang berikut.

A.



B.



C.



D.



Hitung setiap yang berikut.

1)
```
   RM 5 6 0 0
+  RM   8 0 0
   RM
```

2)
```
   RM 8 2 0 4. 9 0
+  RM   1 5 5. 0 0
   RM
```

3)
```
   RM 6 0 0 0. 3 5
+  RM 3 9 9 9. 6 5
   RM
```

4)
```
   RM 8 9 2 0
-  RM 1 5 2 5
   RM
```

5)
```
   RM 4 8 2 5. 0 0
-  RM 1 4 2 3. 4 5
   RM
```

6)
```
   RM 7 5 0 0
-  RM 1 4 0 0
   RM
```

7)
```
   RM 6 2 2
   X      9
   RM
```

8)
```
   RM 3 1 5. 1 0
   X           4
   RM
```

Hitung jumlah harga barang dibawah.

A)

RM1.20

RM2.50

B)

RM4370

RM179.90

C)

RM678.90

RM165.90

D)

RM69.90

RM79.80

Padankan mata wang dengan negara yang betul

a)

b)

c)

INDONESIA

BRUNEI

LAOS

THAILAND

SINGAPURA

d)

e)