Nama: ..... Kelas: ..... Tarikh: .....

Unit 7: Bentuk **Standard Kandungan:** 7.1

Tahap Penguasaan: TP1, TP2 **Standard Pembelajaran:** 7.1.1; 7.1.2

A. Tulis nama bagi prisma berikut dan bahagiannya. Guna perkataan yang diberikan.

Prisma segi tiga | Bucu | Permukaan rata | Tepi | Prisma segi empat tepat

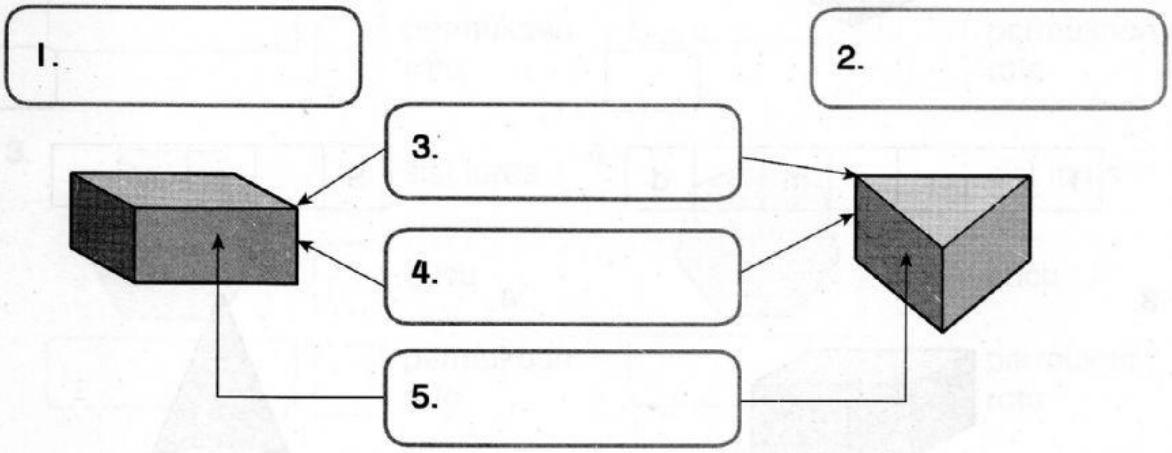

B. Isi tempat kosong dengan nombor yang betul.

1.



☐ permukaan rata

☐ bucu

☐ tepi

2.



☐ permukaan rata

☐ bucu

☐ tepi

3.

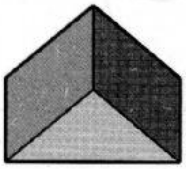

☐ permukaan rata

☐ bucu

☐ tepi

4.

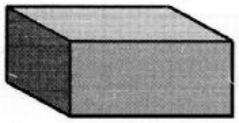

☐ permukaan rata

☐ bucu

☐ tepi

Menguasai	☐

Belum Menguasai	☐