UNIT 7 : RUANG

A. KENAL POLIGON SEKATA

1. Tonton video di bawah untuk mengetahui dengan lebih lanjut mengenai poligon sekata.

2. Namakan poligon di bawah.

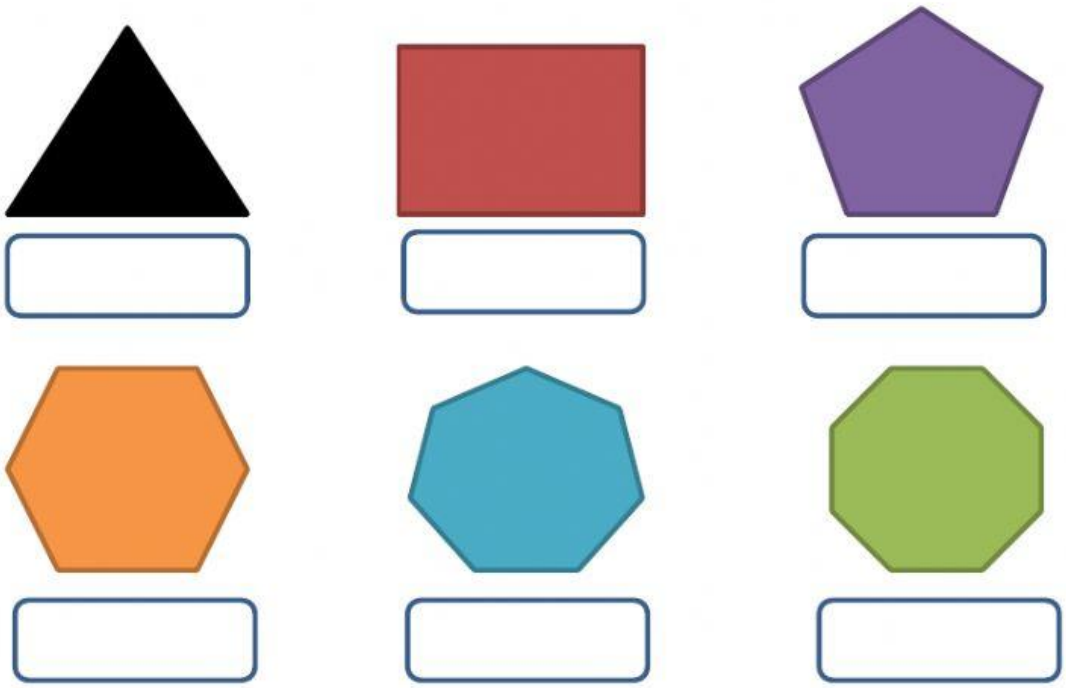

3. Labelkan bucu dan sisi lurus pada poligon.

a

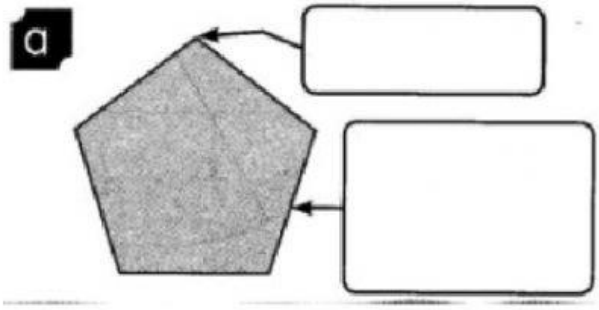

b

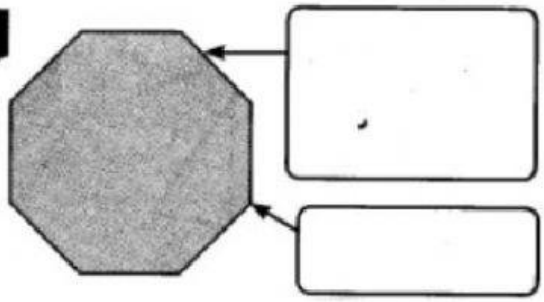

4. Lengkapkan bilangan bucu dan sisi lurus setiap poligon.

a



Pentagon mempunyai _____ bucu dan _____ sisi lurus.

Heptagon mempunyai _____ bucu dan _____ sisi lurus.

b



c



Oktagon mempunyai _____ bucu dan _____ sisi lurus.

Heksagon mempunyai _____ bucu dan _____ sisi lurus.

d



B. REKA CORAK

Lengkapkan jadual.

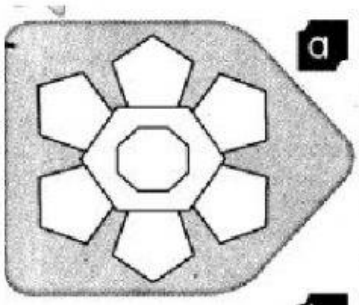

a

Poligon	Bilangan

b

Poligon	Bilangan

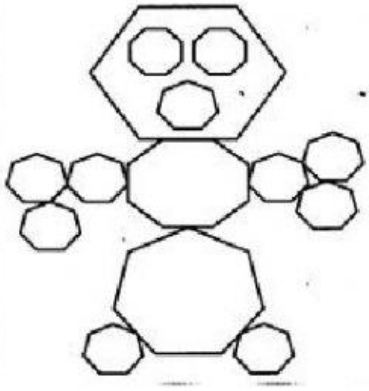

C. PAKSI SIMETRI

1. Tonton video di bawah untuk mengetahui dengan lebih lanjut mengenai paksi simetri.
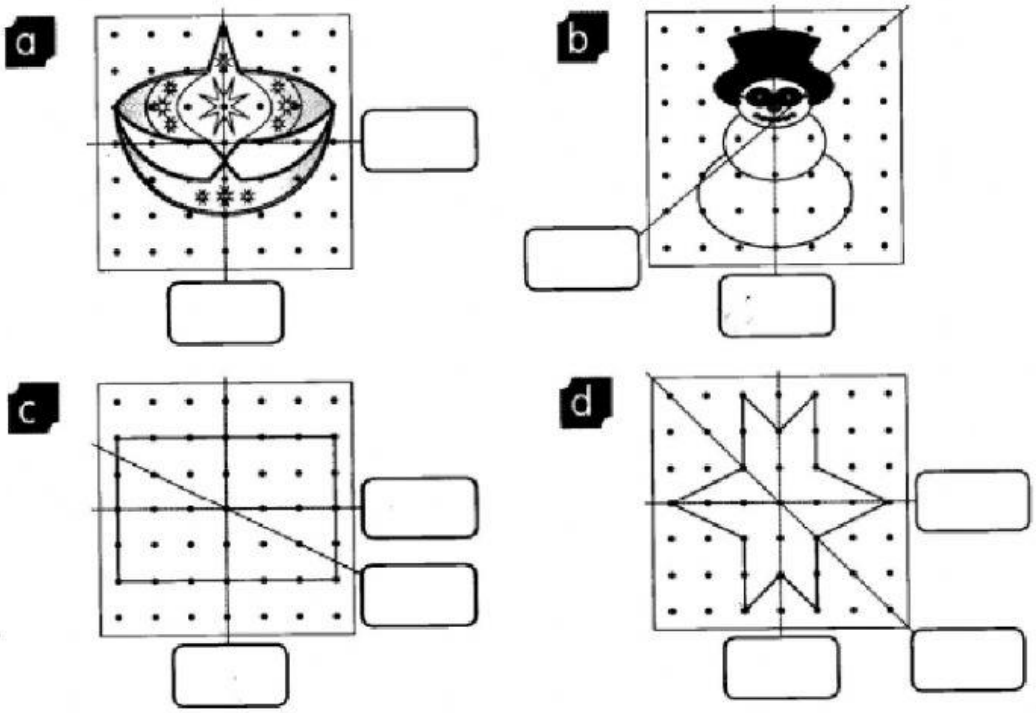
Tandakan (/) pada paksi simetri.