KENDRIYA VIDYALAYA NO.1 , SHAHIBAUG,AHMEDABAD

WORKSHEET

CLASS : 5 SUBJECT: MATHS

FILL IN THE BLANKS

(1) ½ of a dozen= _____

(2) ¾ of Rs 100 = _____

(3) 25 paisa is _____part of rupee 1 .

(4) If 1kg = 1000 kg, then ¼ of a kg = _____

(5) First equivalent of 2/3 = _____

(6) If 1 litre = 1000 ml , then ¾ litre = _____

(7) How much part is colored ?_____

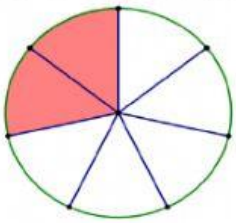

(8) If you will get 4/8 part of the cake , how many pieces of cake you will get? _____


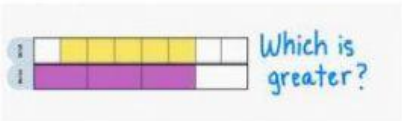
(9) Which part is more yellow colored or purple colored?_____