# MATEMATIK TAHUN 4
# BAB 6 : RUANG

Rujukan Buku Teks : 206-208

**LATIHAN 6.2**

a. Hitung luas kawasan berlorek.

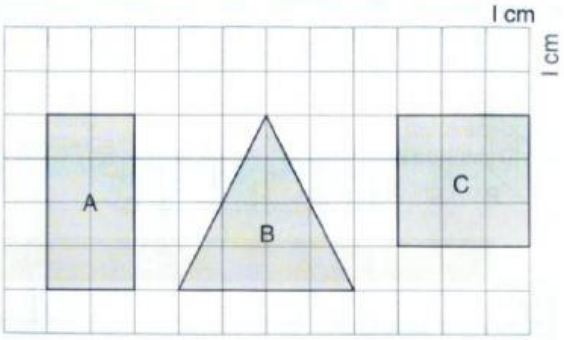


Luas A = ____ cm²  Luas B = ____ cm²  Luas C = ____ cm²

b. Hitung luas rajah berikut.

1.




Luas = _____ cm²

2.

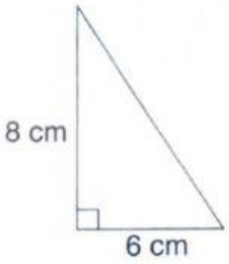


Luas = _____ cm²

3.

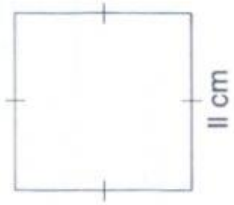


Luas = _____ cm²

4.

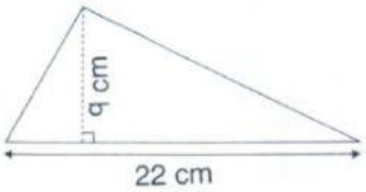


Luas = _____ cm²

5.

Luas = _____ cm²

6.

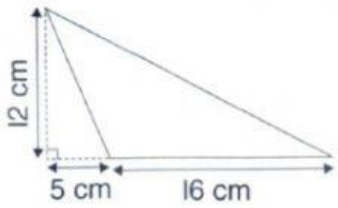


Luas = _____ cm²