Name: _____

Ordinal Numbers and Non-Standard Measurement

Look at the pictures. Write the correct answer.

				
zebra	*elephant*	*turtle*	*pig*	*pony*

2nd _____ 5th _____

1st _____ 3rd _____

4th _____

Count the cubes. Then write how many.

			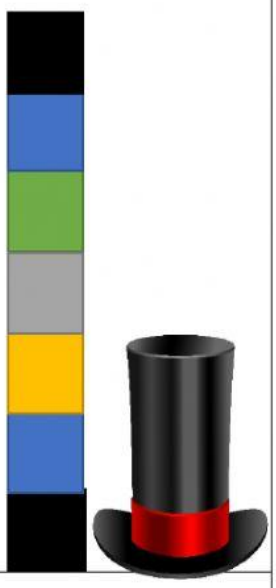
_____cubes	_____cubes	_____cubes	_____cubes