22 Προβλήματα

1

Πόσες καρέκλες θα χρειαστούμε ακόμα για να καθίσουν 10 καλεσμένοι;

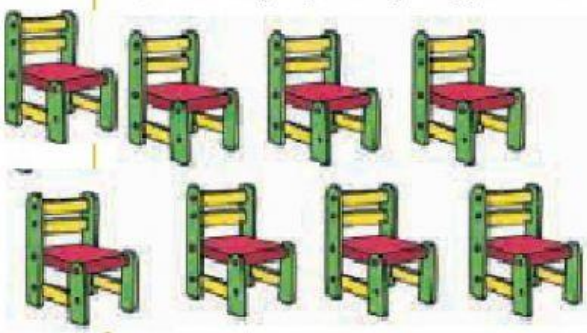

+ □ = 10

Πόσες πεταλούδες πρέπει να πετάξουν
από το κόκκινο στο κίτρινο λουλούδι, έτσι ώστε τα δύο λουλούδια
να έχουν τον ίδιο αριθμό πεταλούδων;



....+.....=

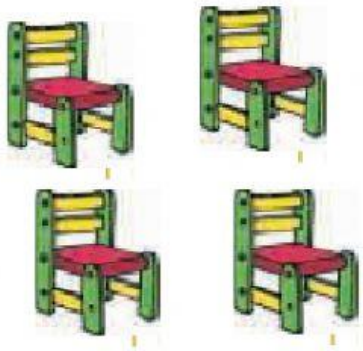

+ =9

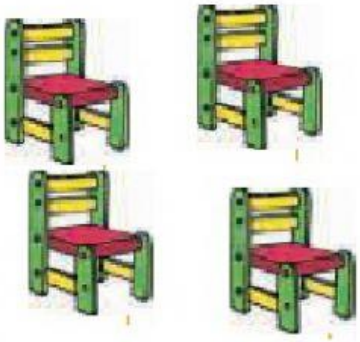

+ =10

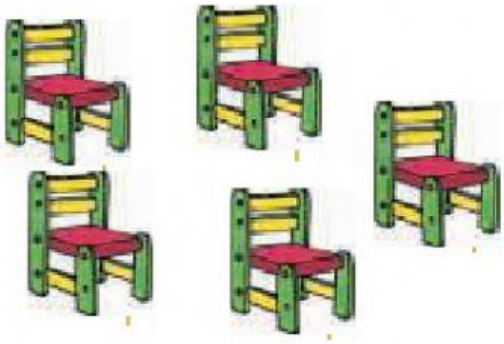

+ =8



+ =7