Prepared by : Madam Noor Hafizah bt Abdullatap

Name : _____
Class : 5 GLOBAL
Topic : VOLUME

CUBE

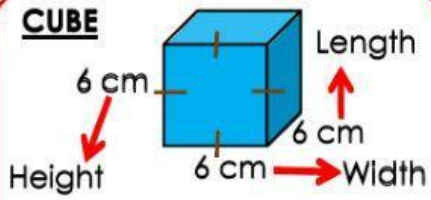

Length X Width X Height =
6 cm X 6 cm X 6 cm = 216 cm^3

CUBOID

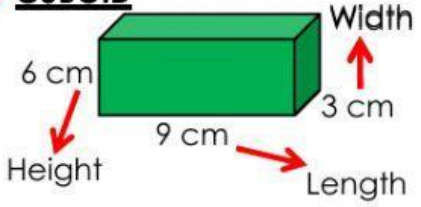

Length X Width X Height =
9 cm X 3 cm X 6 cm = 162 cm^3

COMPOSITE SHAPE

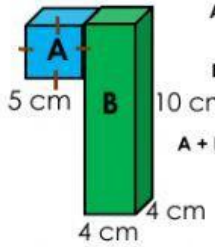

A = 5cm X 5cm X 5cm
= 125 cm^3

B = 4cm X 4cm X 10cm
= 160 cm^3

A + B = 125 cm^3 + 160 cm^3
= 285 cm^3

Find the volume of the composite shapes below.

1)

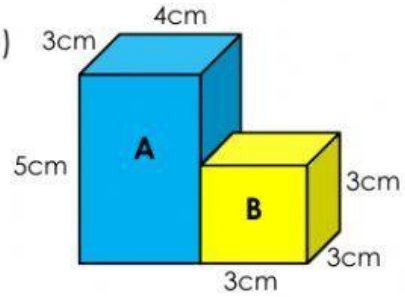

A = cm^3
B = cm^3
A + B = cm^3

2)

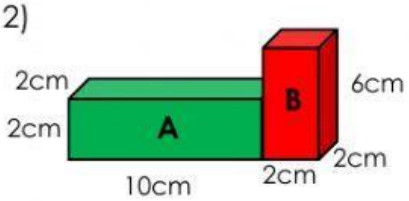

A = cm^3
B = cm^3
A + B = cm^3

3)

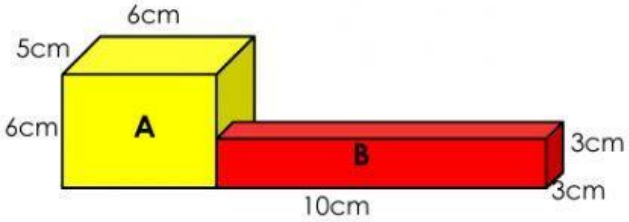

A = cm^3
B = cm^3
A + B = cm^3

4)

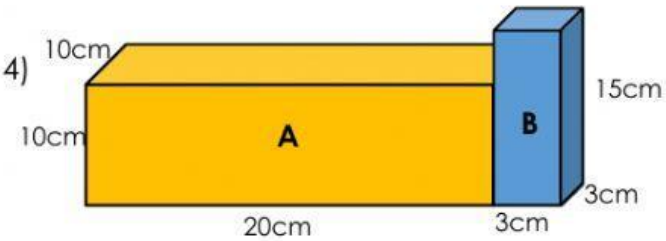

A = cm^3
B = cm^3
A + B = cm^3