ATIVIDADES

1 **Ajude o Mario a encontrar o quadrado que corresponde a área de 2500 m²**









2 **Ajude o Luigi a calcular a área em m² e perímetro em m de cada polígono:**
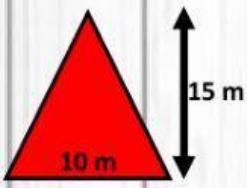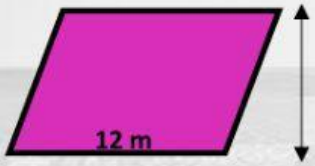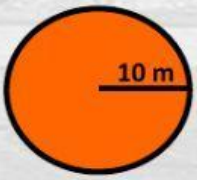
	Área	Perímetro