Counting tens and ones

Grade 1 Base Ten Blocks Worksheet

Find the total number of blocks.

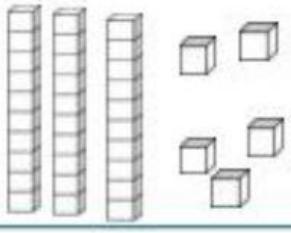

= 3 tens + 5 ones = 35

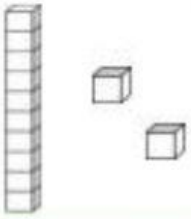

= __ tens + __ ones = ____

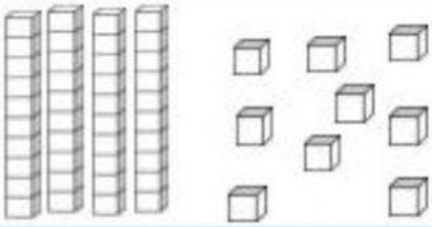

= __ tens + __ ones = ____

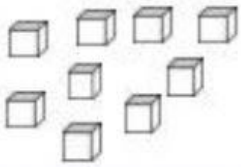

= __ tens + __ ones = ____

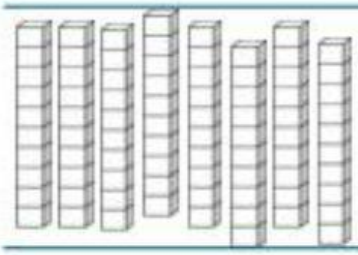

= __ tens + __ ones = ____

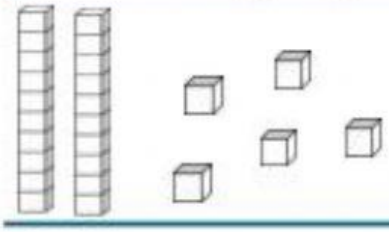

= __ tens + __ ones = ____