Ayo, tentukan panjang busur pada lingkaran-lingkaran berikut!

1.

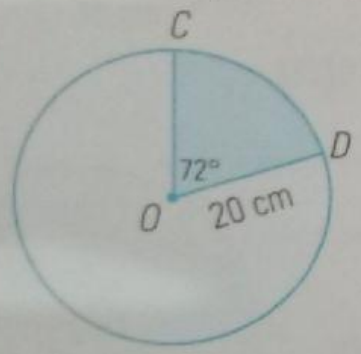

Panjang busur CD = ...

2.

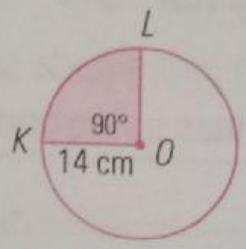

Panjang busur KL = ...

3.

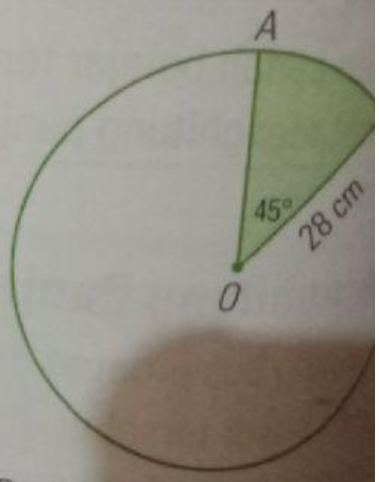

Panjang busur AB = ...

Latihan 5 Menghitung luas juring lingkaran.

Ayo, tentukan luas juring pada lingkaran-lingkaran berikut!

1.

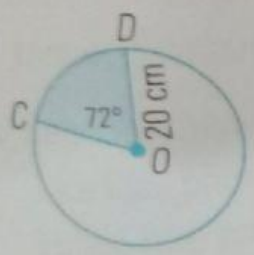

L COD = ...

2.

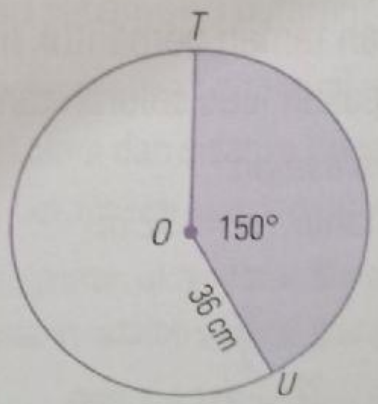

L TOU = ...

3.



L ROS = ...