Тиждень 11. Порівнюємо числа за їх складом

(ім'я)

___ листопада

Порівняй числа за їх складом, користуючись схемами.

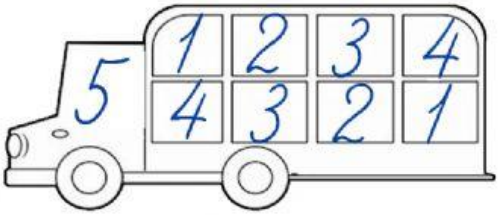

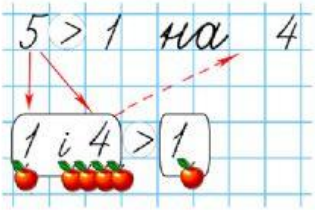

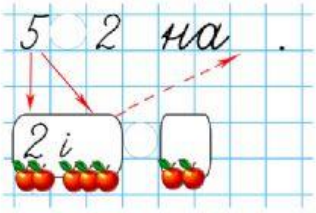

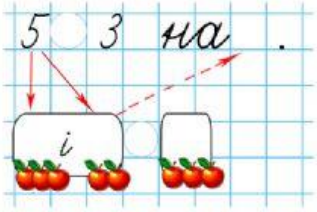

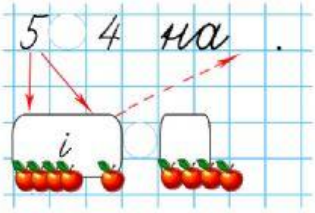

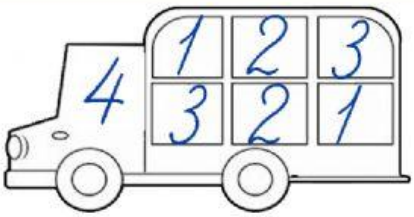

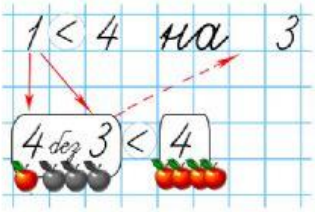

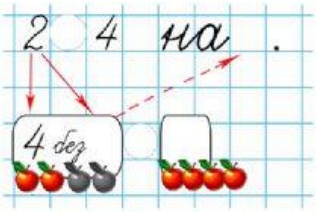

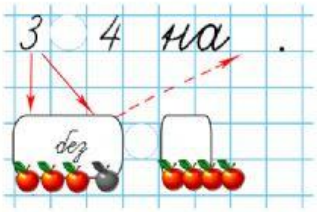

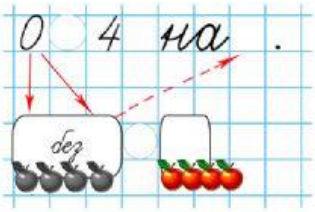

Порівняй числа. Запиши на скільки одне число більше (менше) іншого числа.

5 ◯ 3 на .
4 ◯ 3 на .
2 ◯ 5 на .
1 ◯ 4 на .

5 ◯ 2 на .
4 ◯ 2 на .
5 ◯ 1 на .
3 ◯ 5 на .

5 ◯ 0 на .
5 ◯ 4 на .
4 ◯ 2 на .
1 ◯ 4 на .

Nstrovok