What is the fraction of the shaded part?

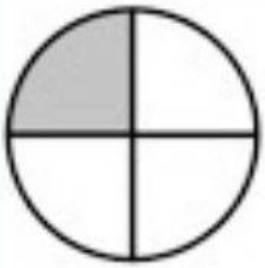 $\frac{1}{4}$	_____
_____	_____
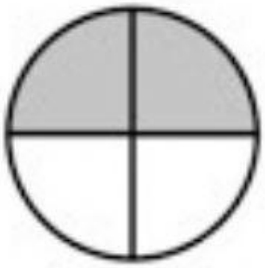 _____	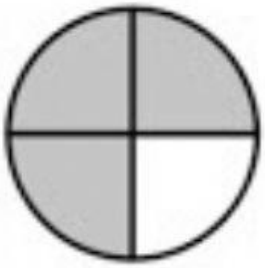 _____
_____	_____
_____	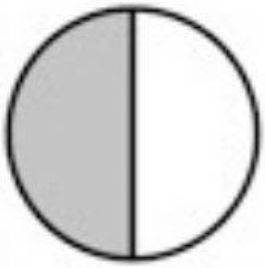 _____