Name :	**Class** : .....
Lesson :	**Attendance List**: .....

Bismillaahirrohmaanirrohiim

Retype : **"I am an honest kid. I'll do the best for Allah"**

Complete the addition and subtraction below!

1. 6579 + 403 = ...
2. 357 + 7213 = ...
3. 3682 + 1405 = ...
4. 5738 + 2462 = ...
5. 2157 + 7475 = ...
6. 1463 – 230 = ...
7. 8724 – 324 = ...
8. 3685 – 2304 = ...
9. 9784 – 3523 = ...
10. 6517 – 5256 = ...

Determine the sizes and type of the angles below!

1. ..... °

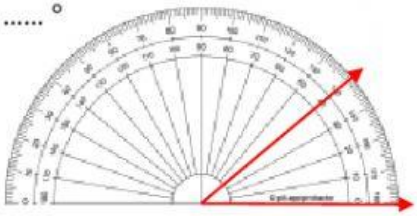

a. an acute angle
b. an obtuse angle
c. a right angle

2. ..... °

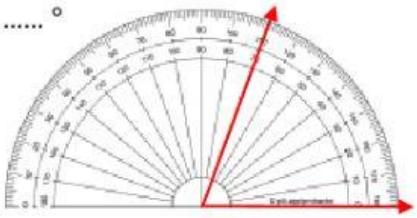

a. an acute angle
b. an obtuse angle
c. a right angle

3. ..... °

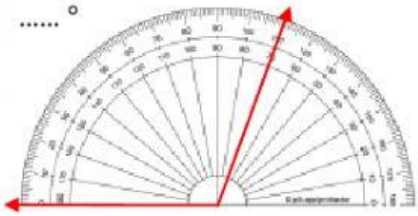

a. an acute angle
b. an obtuse angle
c. a right angle

4. ..... °

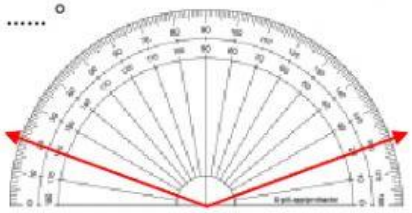

a. an acute angle
b. an obtuse angle
c. a right angle

5. ..... °

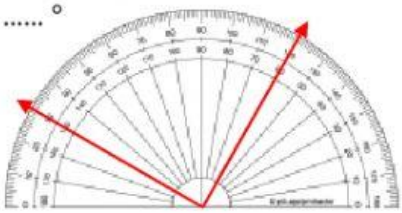

a. an acute angle
b. an obtuse angle
c. a right angle

6. ..... °

a. an acute angle
b. an obtuse angle
c. a right angle

Determine type of the angles from the objects below!

1. White Board is .....

a. an acute angle
b. an obtuse angle
c. a right angle

2. Rocket is .....

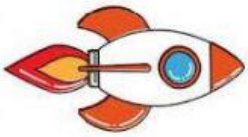

a. an acute angle
b. an obtuse angle
c. a right angle

3. Lounge chairs is .....

a. an acute angle
b. an obtuse angle
c. a right angle

Alhamdulillaahirobbil'aalamiin