Name of the Student: .....R.No: .....

Name of the Schoo l: ..... Mandal: .....

Class: 6th Subject: MATHEMATICS Topic: LINES & ANGLES

.....

**Q1. Write the line segments of the given Triangle ABC :**

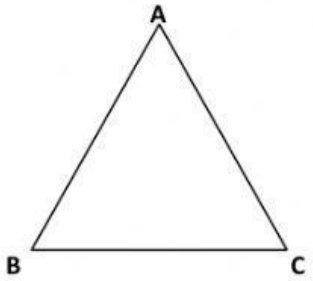


1 .....

2 .....

3 .....

**Q2. Write the Angles of the given Rectangle ABCD.**




1. ..... . 2 .....

3 ..... 4 .....

**3. Name the given polygons: ( SQUARE, TRIANGLE, PENTAGON)**

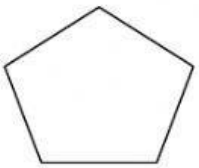



..... ..... .....