Which Has A Greater Mass?

Put an X in the box for the object with the greater mass.

1. ☐ bus

☐  building

2. ☐ apple

☐ ant

3. ☐ sock

☐ dog

4. ☐  elephant

☐ mouse

Put an X in the box that has the correct amount for each measurement given.

Measurement Mania:

CUPS, PINTS and QUARTS


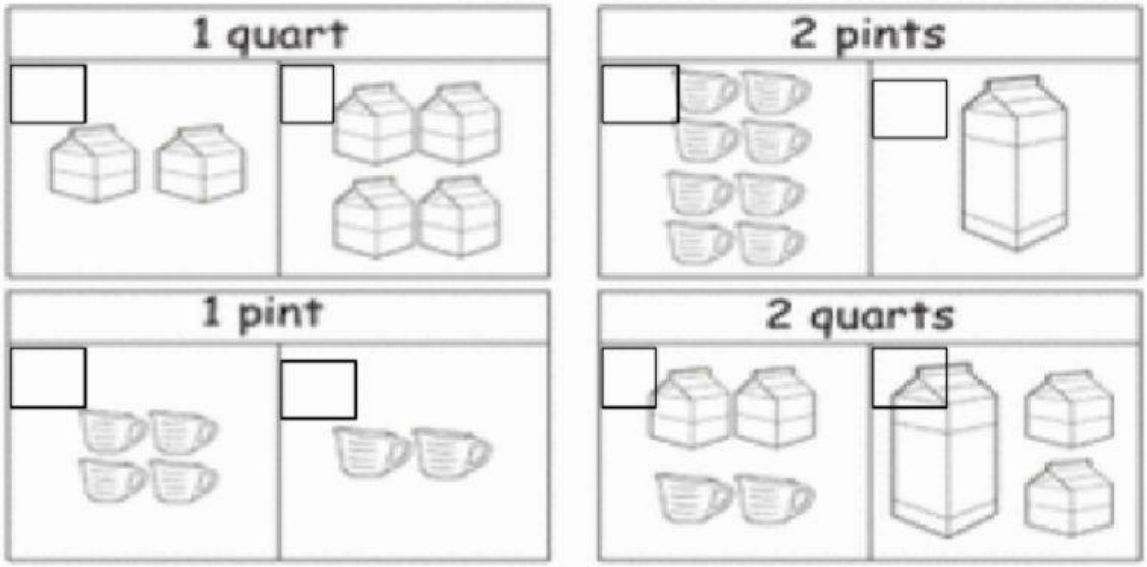
1 cup 2 cups = 1 pint 4 cups = 1 quart