THE ORGANISATION OF LIVING THINGS

Living or non living things? Choose the correct answers

Living thing
Non living thing

Living thing
Non living thing

Living thing
Non living thing

Living thing
Non living thing

Living thing
Non living thing

Nutrition, interaction or reproductio? Match

Create new living things

Nutrients

Nerve cells

NUTRITION

INTERACTION

REPRODUCTION

What is the name of these parts of the cell?

Nucleus | Cell membrane | Cytoplams | other organelles

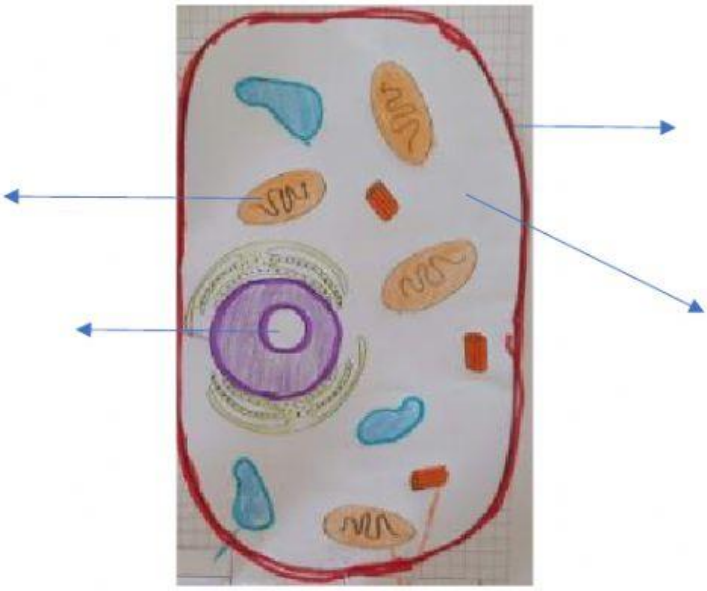

Nucleus | Cell membrane | Cytoplams | Cell wall | large vacuole

chloroplasts

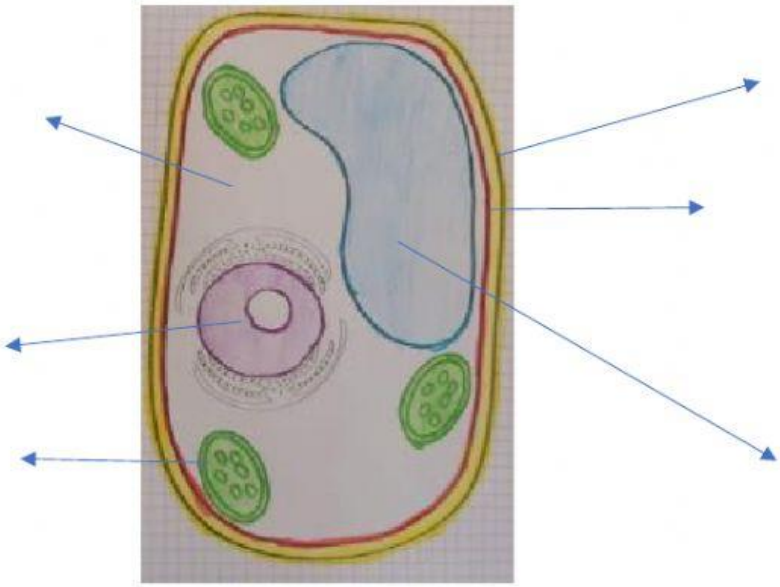

Choose the correct words

All living things are made up of _____. They perform three vital functions: _____, _____ and _____.

Living things can be _____ (like bacteria) because they are made up of just one cell, or _____ (like animals, plants, and fungi), because they are made up of more than one cell.

Write the correct word
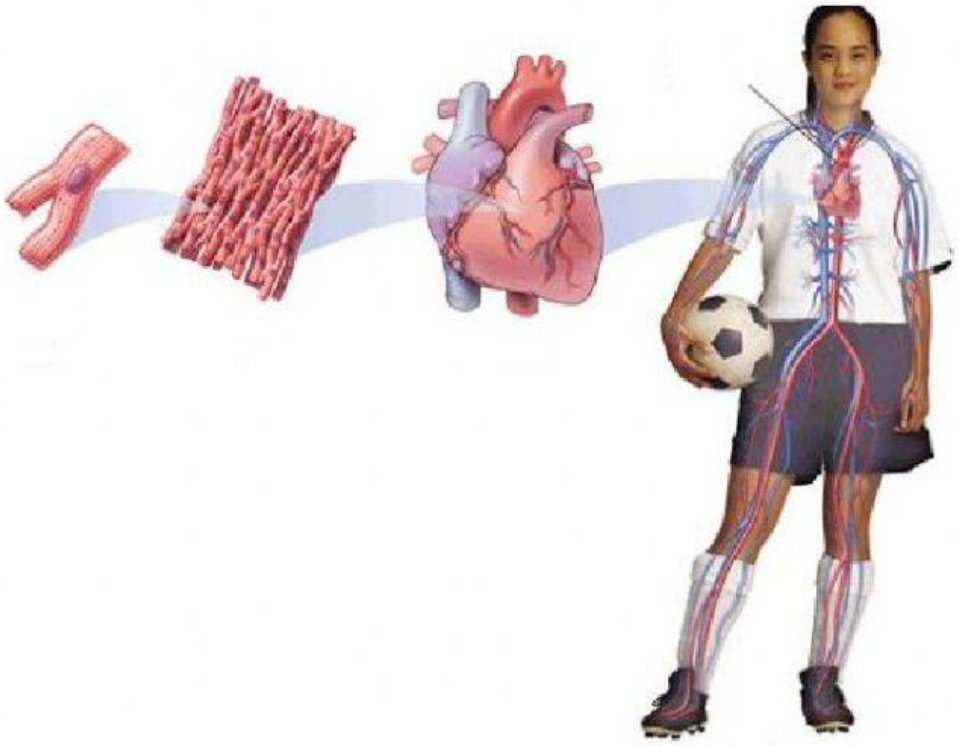
Organism - organ – cell – system - tissue