Name: _____

שטח משולש

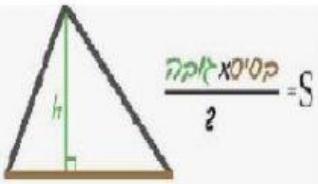

הוראות: מצאו את השטחים של כל המשולשים הבאים.
העלו לגוגל קלאסרום כאשר אתם מסיימים את המשימה.

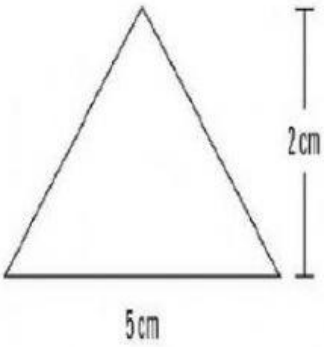

A = _____ cm^2

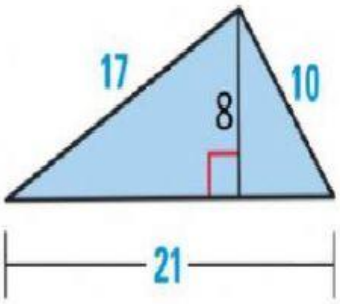

A = _____ $units^2$

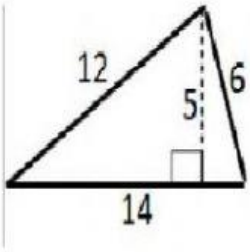

A = _____ $units^2$

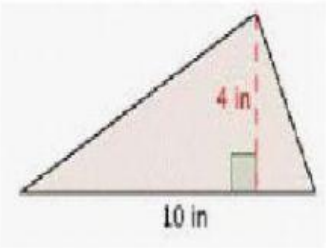

A = _____ in^2

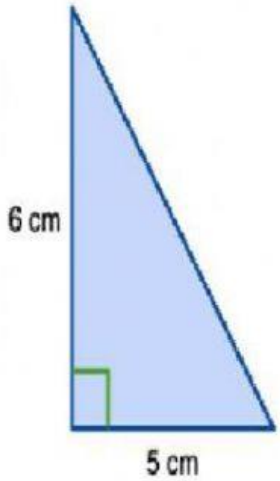

A = _____ cm^2

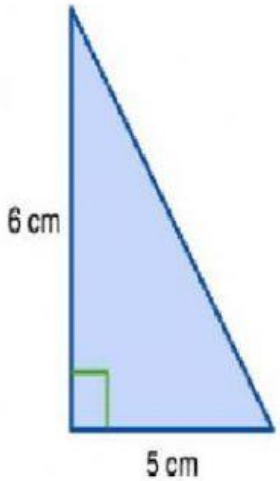

A = _____ cm^2

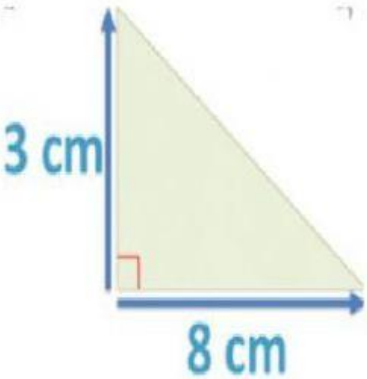

A = _____ cm^2

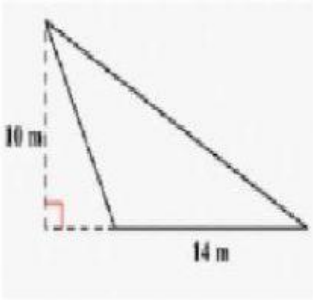

A = _____ m^2