ورقة عمل لتقريب الأعداد لأقرب عشرة ومئة وألف

الاسم	
الصف	
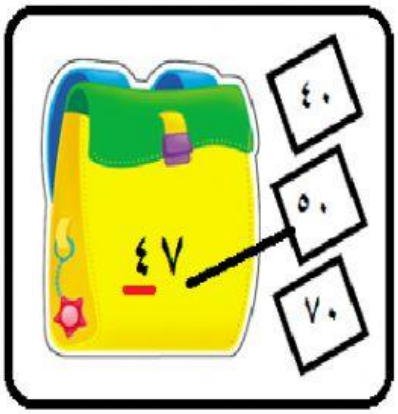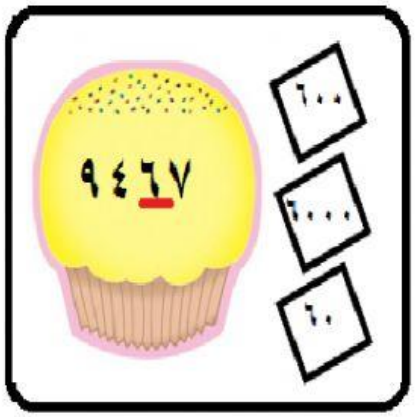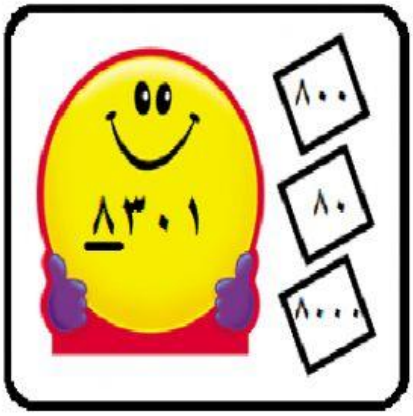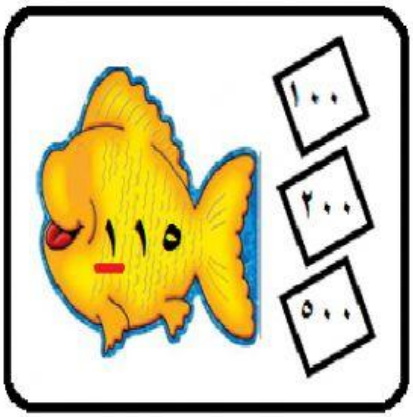
قربي كل عدد مما يأتي إلى المنزلة التي تحتها خط ثم صليها بالإجابة الصحيحة كما في المثال الأول :