اكتب معادلة في صورة رمز دالة لكل علاقة.

5

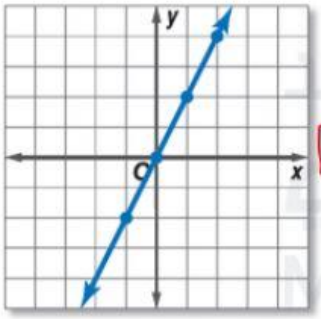

F(x) =

6.

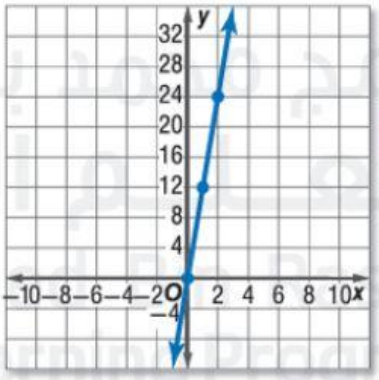

F(x) =

7.

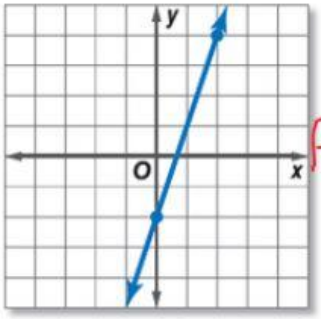

F(x) =

8.

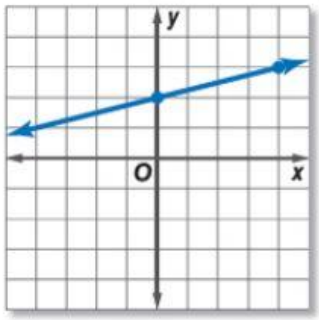

F(x) =

برنامج محمد بن راشد للتعلم الذكي
Mohammed Bin Rashid Smart Learning Program