UNITED ARAB EMIRATES
MINISTRY OF EDUCATION
Al Dahfra
Al Selaa School

الإمارات العربية المتحدة
وزارة التربية والتعليم
الظفرة
مدرسة السلع

Read the problem. Draw a line through the correct number of objects. Write the answer under the line.

Example



5
− 2

8
− 1



10
− 3



8
− 6

5
− 3

7
− 4



10
−10

6
− 6

8
− 2

I