NAME: _____

I. Classify the images into Living and Non – living things.

LIVING THINGS	NON – LIVING THINGS

2. Look at the images and classify the life cycle into BORN, GROW, REPRODUCE AND DIE.

EXAMPLE:

BORN REPRODUCE DIE GROWS





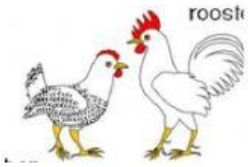

---------- ---------- ---------- _____



---------- ---------- ---------- ----------