KENDRIYA VIDYALAYA SANGATHAN

AHMEDABAD REGION

LIVE WORKSHEET

CLASS : 2 SUBJECT : MATHS TOPIC : LINES AND LINES

NAME OF THE STUDENT: _____

Q : 1 CLASSIFY THE OBJECTS AS STANDING, SLANTING, SLEEPING OR CURVED.

1

2



3

4



5

6

7

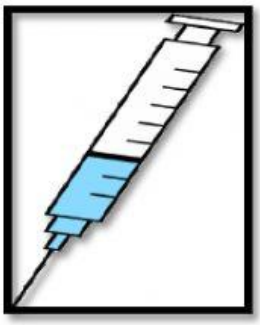

8

9

10



11

12

13



14

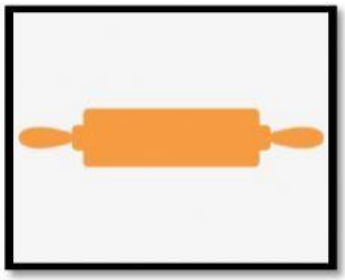

STANDING	SLEEPING	SLANTING	CURVED

Q : 2 MATCH THE FOLLOWINGS.

A	B
- Curved line	
- Standing line	
- Slanting line	
- Sleeping line	

Q : 3 COUNT AND WRITE NUMBER OF STANDING, SLEEPING, SLANTING AND CURVED LINE IN GIVEN DIGIT.

STANDING LINES	
SLEEPING LINES	
SLANTING LINES	
CURVED LINES	