Name: _____

Number Bonds

Finish the number bonds and complete the number sentences.



10 → 3, ___

10 − 3 = ___

8 → 4, ___

8 − 4 = ___



6 → 2, ___

6 − 2 = ___



9 → 5, ___

9 − 5 = ___