Weekly Test – Mathematics

Listen to each problem carefully, then solve:

1. Fill in the missing numbers.



2. Complete the sentences using one of the words:

heavier

lighter

balanced

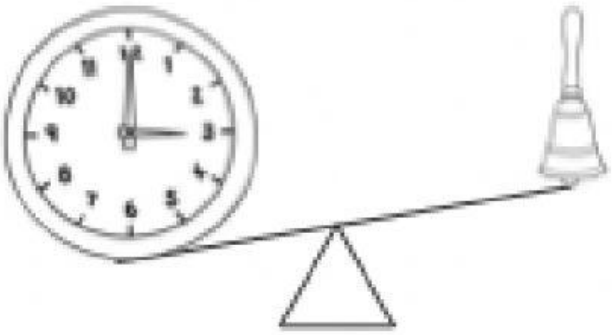

The clock is _____ than the bell.

The bell is _____ than the clock.

3. Put the numbers below in <u>ascending order</u>.

14, 5, 20, 3



4. Compare the numbers below. Write **greater than** > or **less than** < to complete the statement.

7 ☐ 15

5. 13 + 5 = _____

6. 2 + 4 + 8 = _____

7. 12 – 5 = _____

8. There are 8 elephants in a zoo.

6 more are brought to the zoo.

How many elephants are there in total?

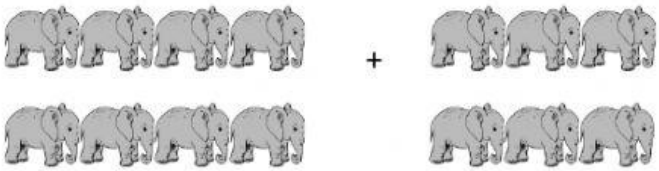

_____ + _____ = _____

There are _____ elephants in total.

9. I caught 5 butterflies on Monday, 4 butterflies on Tuesday and 10 butterflies on Wednesday. How many butterflies did I catch in all?



_____ + _____ + _____ = _____

There are _____ butterflies in all.

10. Emma has 9 cookies. She eats 3 cookies. How many cookies does she have left?



_____ - _____ = _____

Emma has _____ cookies left.