Name: _____

Writing Numbers in

Expanded Form

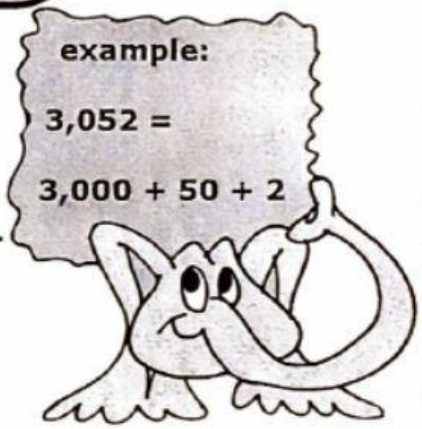

Write each number in expanded form.

a. 9,245 = _____ + _____ + _____ + _____

b. 1,203 = _____ + _____ + _____

c. 7,889 = _____ + _____ + _____ + _____



d. 8,035 = _____ + _____ + _____

e. 3,476 = _____ + _____ + _____ + _____

f. 2,400 = _____ + _____

g. 5,135 = _____ + _____ + _____ + _____

Write these numbers in standard form.

h. 6,000 + 400 + 30 + 6 = _____

i. 7,000 + 50 + 8 = _____



j. 2,000 + 900 + 60 + 9 = _____

k. 4,000 + 700 + 7 = _____

l. 9,000 + 900 + 90 + 9 = _____