BLUMENAU - SANTA CATARINA
EBM CONSELHEIRO MAFRA
PROF. CLEITON SÁ
7º ANO

NÚMEROS INTEIROS

Exercícios de fixação

1) Nas pirâmides a seguir, cada tijolinho é representado pela **adição algébrica** dos dois tijolinhos de baixo. Com base nesta ***lei***, preencha os números que faltam.

a)

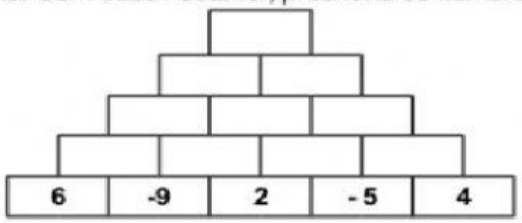

b)

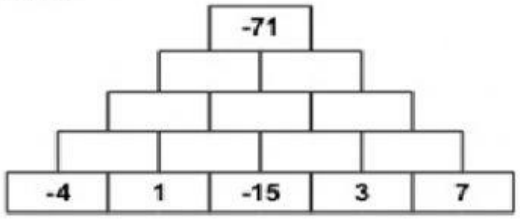

c)

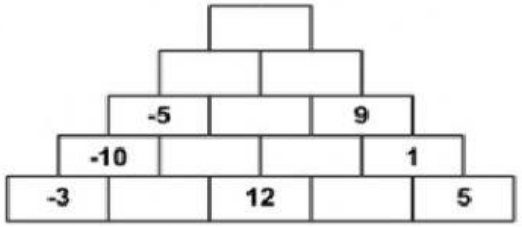
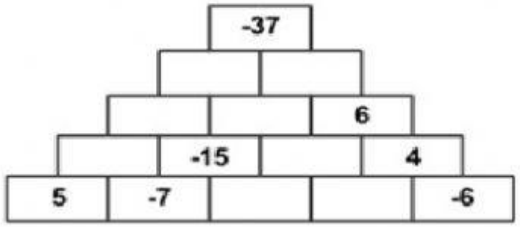
d)