Instructions: Match the part of the map with the right answer.

1. Tells you what the map is about.
2. Shows the directions.
3. Are the four main directions in a compass rose.
4. Shows what the symbols on the map means.
5. Helps you find places quickly in a map. It shows a specific point in the map with the use of rows and columns.

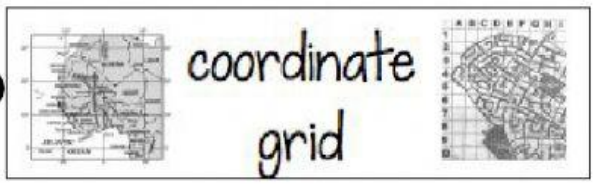



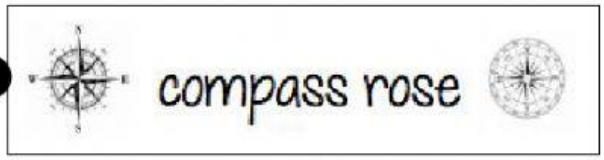

north, south, east and west