LATIHAN KD 4.2.1

SDK 6 BPK PENABUR

Kelas/Semester : IV/1 Mata Pelajaran : Matematika Materi : Pecahan Kompetensi : 4.2	Nama :	Nilai	TTOT
	Kelas/No.:		
	Tanggal :		

Lengkapi tabel berikut dengan menuliskan bentuk pecahan, desimal dan persen berdasarkan bagian yang diarsir pada gambar!

No.	Model	Pecahan	Desimal	Persen
1	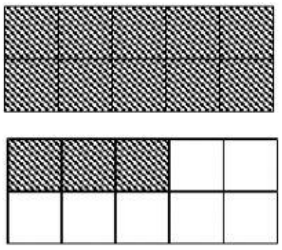	a.	b.	c.
2		a.	b.	c.
3	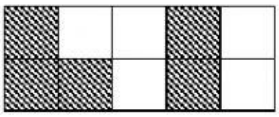	a.	b.	c.
4		a.	b.	c.
5		a.	b.	c.