LEMBARAM KERJA SISWA (LKS) SEMESTER GANJIL

SDN KARANG TENGAH 7

TAHUN PELAJARAN 2020/2021

Jl. Komplek Barata Raya Karang Tengah – Kota Tangerang

Nama : ……..	Mata Pelajaran : Matematika
Kelas : VI A (Enam)	Materi Pembahasan : Unsur Lingkaran..
Guru : **SUHENDAR, S.Pd**	Hari/Tanggal : ……

Kerjakan Soal-Soal Berikut ini!

1. Hubungkan dengan garis pada jawaban yang benar :

a.

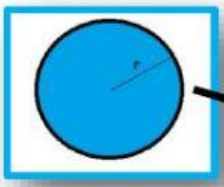

b.

c.



d.

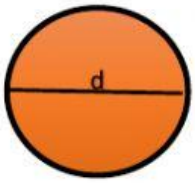

APOTEMA

JARI--JARI

DIAMETER

BUSUR

2. Pilihlah nama unsur lingkaran yang sesusai gambar bangun dibawah ini :

a.

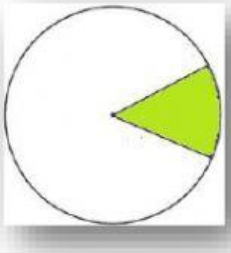

b.

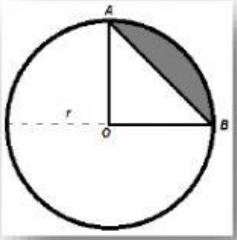
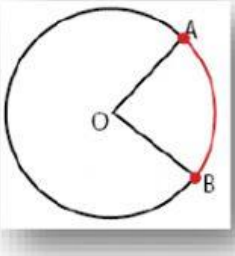
c.