Name:_____ Date:_____ #____

Add:

1. 9 + 4 = _____

2. 3 + 14 = _____

Subtract:

3. 16 - 14 = _____

4. 19 - 15 = _____

5. Fill in the missing number.

8 + _____ = 10

6. Compare the two numbers by writing >, <, or = in the circle.

15 ◯ **13**

7. Name this shape.

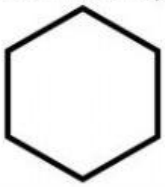

8. Ben used 8 apples to make a pie . Sue used seven apples to make a pie. How many apples did they use in all?

9. How many kids walk to school?

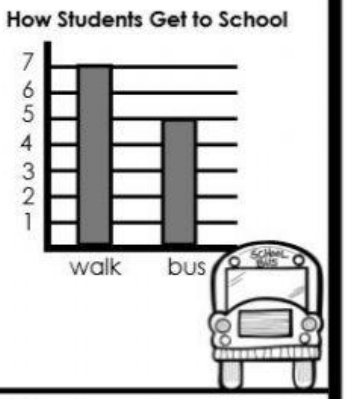

10. What time is it?



#	answer
1	
2	
3	
4	
5	
6	
7	
8	
9	
10	

©www.CFClassroom.com