1. **Escriu la fracció que representa la línia vermella d'aquestes rectes numèriques:**

a) 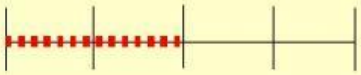 = ___

b) 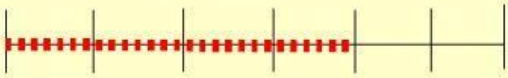 = ___

c) 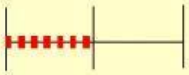 = ___

e) 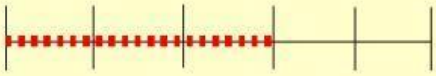 = ___

2. **Relaciona cada dibuix amb la recta numèrica que la representa:**

a)  =

b) 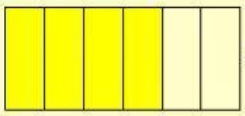 =

c) 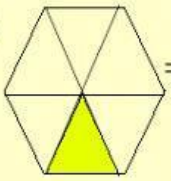 =

d) 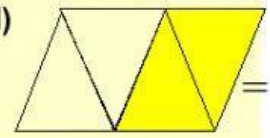 =

e)

g) 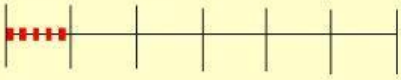

f) 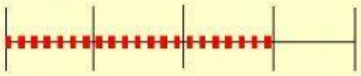

h) 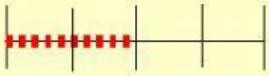

3. Mou cada fracció a la recta numèrica corresponent:

$\frac{2}{4}$ $\frac{4}{5}$ $\frac{1}{3}$ $\frac{2}{6}$ $\frac{5}{7}$ $\frac{1}{8}$

a)

b)

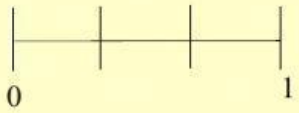

c)

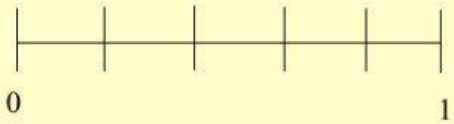

d)



e)

f)