The Posh Oak Academy

RC 1416070

MATHEMATICS

MULTIPLICATION OF 6 TIMES TABLE

WATCH THE VIDEO BELOW AND ANSWER THE QUESTIONS.

6 TIMES TABLE - GROUPS OF 6

Change these groups of 6s into 6 times table facts.

= __ x __ = 12

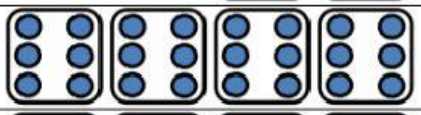

= __ x __ = ____

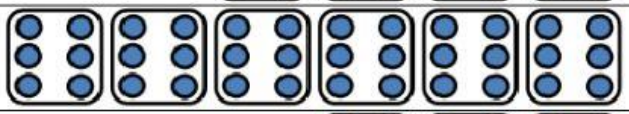

= __ x __ = ____

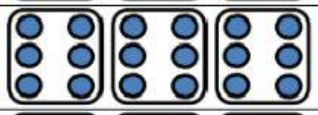

= __ x __ = ____

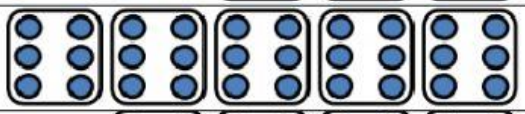

= __ x __ = ____



= __ x __ = ____

= __ x __ = ____

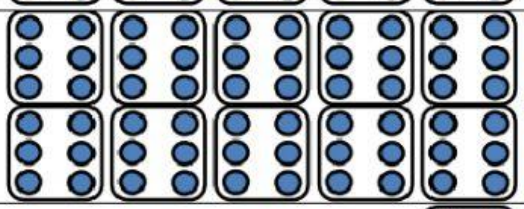

= __ x __ = ____

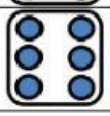

= __ x __ = ____

FILL IN THE MISSING NUMBERS.

6 TIMES TABLE – COUNT BY 6s ON A 100 SQUARE

1	2	3	4	5		7	8	9	10
11		13	14	15	16	17		19	20
21	22	23		25	26	27	28	29	
31	32	33	34	35		37	38	39	40
41		43	44	45	46	47		49	50
51	52	53		55	56	57	58	59	
61	62	63	64	65		67	68	69	70
71		73	74	75	76	77		79	80
81	82	83		85	86	87	88	89	
91	92	93	94	95		97	98	99	100

Use your first 10 numbers to help you write out the 6 times table.

6 x 1 = ___ 6 x 2 = ___ 6 x 3 = ___ 6 x 4 = ___ 6 x 5 = ___

6 x 6 = ___ 6 x 7 = ___ 6 x 8 = ___ 6 x 9 = ___ 6 x 10 = ___