Exercise 1.1

1. Look at the squares and answer.

A.

How many ones are there?

_____ one or $1 \times 1 = 1$

B.

How many ones are there?

_____ ones = ____ ten or 1×10 = ____

C. 

a. How many tens are there?

10×1 ten = ____ tens

b. How many ones are there?

10×10 ones = ____ ones

= 1 hundred

D. 

a. How many hundreds are there?

10×1 hundred = ____ hundreds

b. How many tens are there?

10×10 tens = _____ tens

= 1 thousand or $10 \times 100 = 1000$

c. How many ones are there?

10×100 ones = ____ ones = 1 thousand or $1 \times 1000 = 1000$