August 13th, 2020

Reteaching
10-5

Polígonos

Polígonos son figuras cerradas que están hechas de segmentos de líneas rectas.

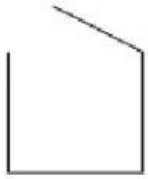

No es un polígono
No es una figura cerrada.

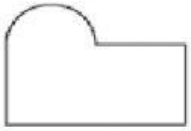

No es un polígono.
No todas las líneas son rectas.

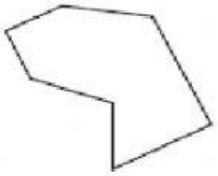

Si es polígono
Es una figura cerrada y todas las líneas son rectas.

Los polígonos se pueden clasificar de acuerdo con su número de lados.

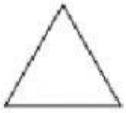

Triángulo
3 lados

Cuadrilatero
4 lados

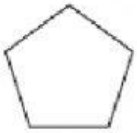

Pentágono
5 lados

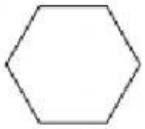

Hexágono
6 lados

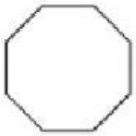

Octágono
8 lados

¿Estas figuras son polígonos? Escoja **si** o **no**. Si la respuesta es si, escribe el **tipo de polígono que es.**

1.

Si

No

Tipo de polígono: _____

2.

Si

No

Tipo de polígono: _____

3.

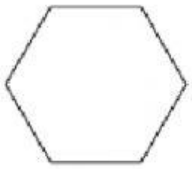

Si

No

Tipo de polígono: _____

4.

Si

No

Tipo de polígono: _____

5. 

Si

No

Tipo de polígono: _____

6. 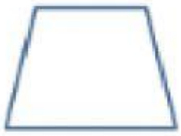

Si

No

Tipo de polígono: _____

7. 

Si

No

Tipo de polígono: _____

8.

Si

No

Tipo de polígono: _____

Escriba el **nombre de cada polígono.**

1. 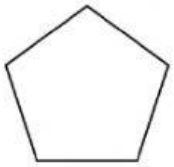

_____

2. 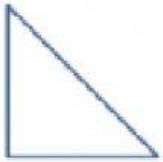

_____

3. 

_____

Complete las siguientes **multiplicaciones.**

9 x 9 = _____ 10 x 6 = _____ 5 x 7 = _____

8 x 5 = _____ 7 x 4 = _____ 6 x 6 = _____