1. Clica l'opció correcta:

Sabem que es tracta d'una PIRÀMIDE quan les seves CARES laterals són...



triangles quadrats rectangles pentàgons

2. Eligeix el nom de les parts d'un prisma:

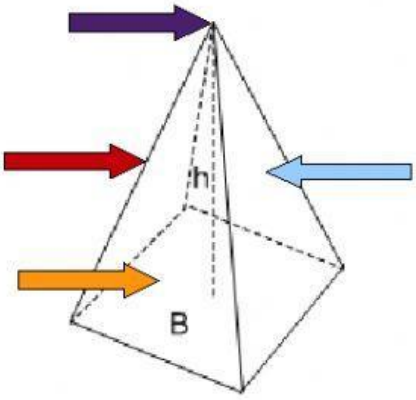

3. Clica les figures que SÍ són piràmides:

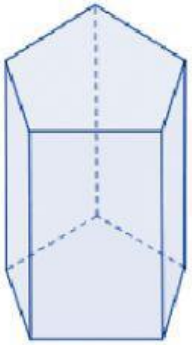
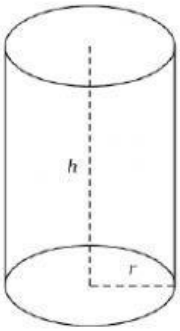

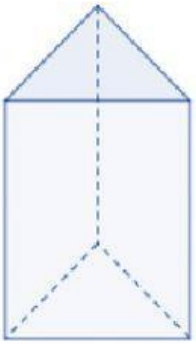
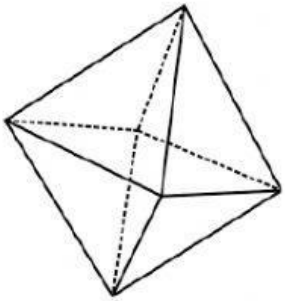
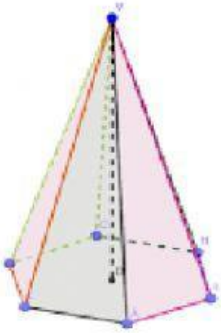
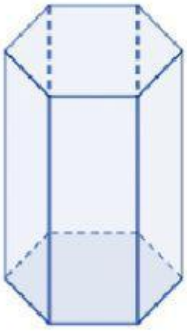
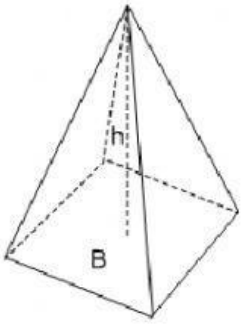

4. Aquí veus alguns desenvolupaments plans de piràmides. Relaciona cada desenvolupament amb la piràmide que li correspon:

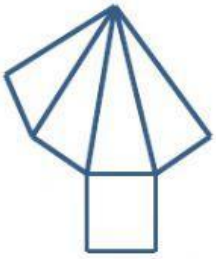

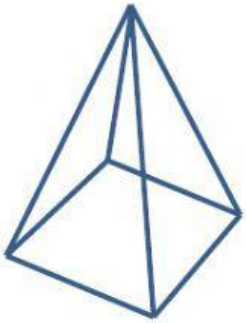
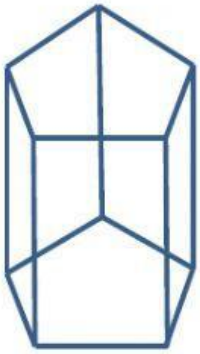

5. Completa aquesta taula:
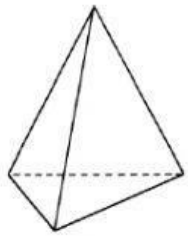
Dibuix	Nº vèrtex	Nº arestes	Nº cares	Nom del prisma: