Tuesday August 11th, 2020

Reteaching
10-4

Angles

Angles are formed by two **rays** that share a vertex. Three types of angles are **right angles**, **acute angles**, and **obtuse angles**.

A **ray** is part of a line that has one endpoint and goes forever in one direction.



A **right angle** forms a square corner.

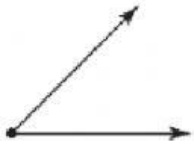

An **acute angle** is less than a right angle.

An **obtuse angle** is more than a right angle.

Lines that meet or cross at a right angle are **perpendicular lines.**

Look at the following angles. Write if each angle is **right**, **acute**, or **obtuse**.

1.

_____

2.

_____

3.

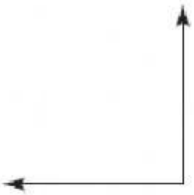

_____

4.

_____

5.

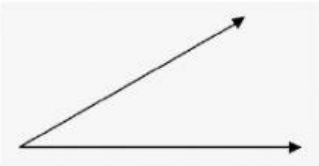

_____

6.

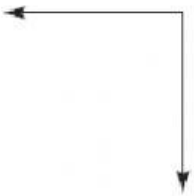

_____

Draw a line to match the images with their concepts.

1. 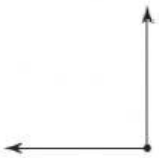

ray

2.

perpendicular rays

3.

angle

Complete the following **multiplication tables.**

2 x 7 = _____ 7 x 5 = _____ 3 x 8 = _____

4 x 6 = _____ 5 x 9 = _____ 1 x 4 = _____