ALL around us

NAME: DATE:

I. LOOK AT THE ITEMS BELOW AND SELECT THE RIGHT STATE.

II. IS IT SOLID , LIQUID OR GAS ? WRITE NEXT TO EACH PICTURE.





III. MATCH

a. Water is a ...	solid
b. Water vopour is a...	liquid
c. Ice is a...	gas

IV. WHAT IS MATTER?

_____

_____

_____

Good effort!



MS. LIA DIOSES