Name _____

Practice
10-2

Relating Solids and Shapes

Look at the rectangular prism below.

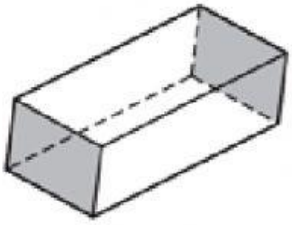

1. How many **faces** does this rectangular prism have?

   _____

2. What is the **shape of each face** of the rectangular prism?

   _____

3. How many **edges** does this rectangular prism have?

   _____

4. How many **vertices** does this rectangular prism have?

   _____

Look at the pyramid below.

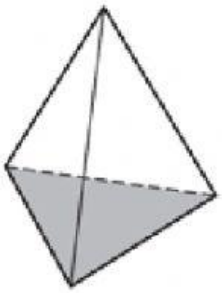

1. How many **faces** does this pyramid have?

   _____

2. What is the **shape of each face** of the pyramid?

   _____

3. How many **edges** does this pyramid have?

   _____

4. How many **vertices** does this pyramid have?

   _____

Look at the cone below.

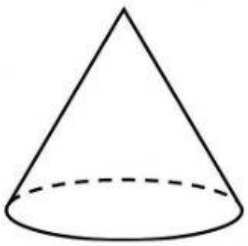

1. How many **bases** does this cone have?

_____

2. How many **vertices** does this cone have?

_____