FITXA: Angles

1.- Arrossega les parts de l'angle al lloc corresponent.

vèrtex

costat

angle

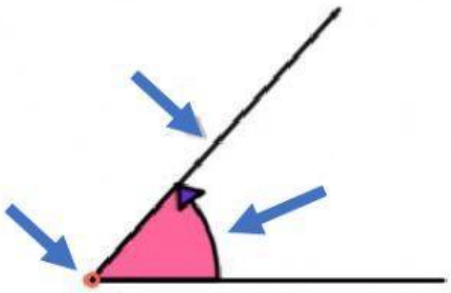

2.- Quant mesura cada angle? EX: 56º

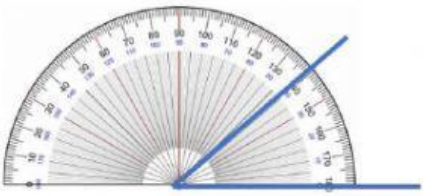

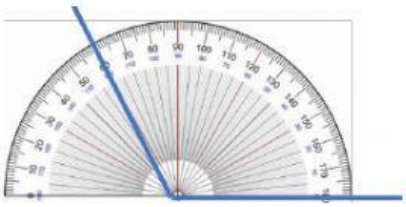

3.- Escriu el nom de cada angle.

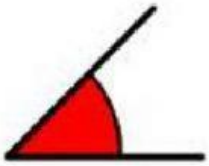



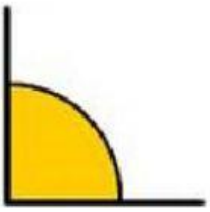

4.- Relaciona:

bisectriu

Línia perpendicular que divideix un segment en dos parts iguals

Línia que divideix un angle en dos angles iguals

5.- Calcula l'angle que es demana. Ex: 75º

Complementari a 35º

Suplementari a 50º

Complementari a 85º

Suplementari a 60º

Angle oposat a un de 70º

Angle oposat a un de 120º

LIVEWORKSHEETS