Area of a Rectangle

T1L153

Find the area of each rectangle.

1)



Area = ( )

2)

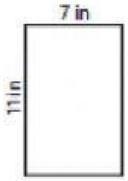

Area = ( )

3)

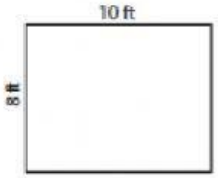

Area = ( )

4)



Area = ( )

5)



Area = ( )

6)

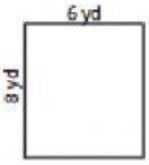

Area = ( )

7)

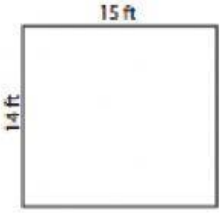

Area = ( )

8)

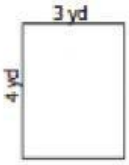

Area = ( )

9)

Area = ( )