# Counting Squares

L251

Find the area of each shape by counting the squares.

1) Scale : ☐ = 4 $ft^2$



Area = _____

2) Scale : ☐ = 5 $in^2$

Area = _____

3) Scale : ☐ = 4 $yd^2$

Area = _____

4) Scale : ☐ = 5 $in^2$



Area = _____

5) Scale : ☐ = 3 $yd^2$



Area = _____

6) Scale : ☐ = 2 $ft^2$

Area = _____

7) Scale : ☐ = 4 $ft^2$



Area = _____

8) Scale : ☐ = 2 $in^2$



Area = _____

9) Scale : ☐ = 5 $yd^2$

Area = _____

10) Scale : ☐ = 2 $in^2$

Area = _____

11) Scale : ☐ = 3 $yd^2$

Area = _____

12) Scale : ☐ = 2 $ft^2$

Area = _____