Counting Squares

L1S2

= 1 ft²

Find the area of each shape by counting the squares.

1)

Area = _____

2)

Area = _____

3)



Area = _____

4)

Area = _____

5)



Area = _____

6)

Area = _____

7)

Area = _____

8)

Area = _____

9)



Area = _____

10)

Area = _____

11)



Area = _____

12)

Area = _____