Name : ..... **Mr / Omar Sholkami** **Alnahyaneia School – Al Ain**

What is the shape of the faces of this object?

A. 

C.

B. 

What object has the faces shown?

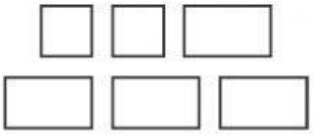

F.

H.

G.

Which three-dimensional shape is not used to make the composite shape shown?

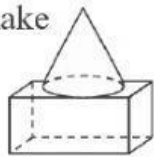

F. 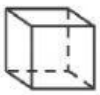

H.

G. 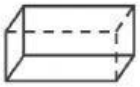

What is the shape of the faces of this object?

A.

C.

B.

What object has the face shown?



F.

H.

G.

Which shape is used to make this composite shape?

A.

B. 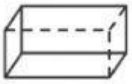

C.

Which shape has 1 face and 1 vertex?

A. 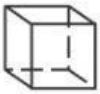

C.

B. 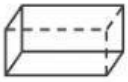

D.

Which object has the faces shown?



F.

G.

H.

I.

Circle the names of the shapes used to make this composite shape.

cone cylinder

cube
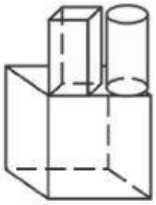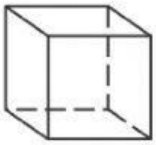
Circle the shapes used to make the composite shape.