**Name:.....** **Mr / Omar Sholkami** **Alnahyaneia School – Al Ain**

Which three-dimensional shape has 2 faces?

**A.** 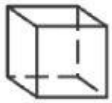

**B.**

**C.**

Which shape is a cone?

**F.**

**H.**

**G.**

How many faces and vertices?

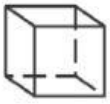

**A.** 6 faces
8 vertices

**C.** 1 face
1 vertex

**B.** 2 faces
0 vertices

---

What is the name of this shape?

**A.** cube

**B.** cylinder

**C.** rectangular prism

**D.** cone

What is the name of this shape?

**F.** cube

**G.** cylinder

**H.** cone

**I.** rectangular prism

How many faces and vertices?

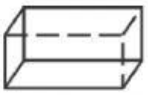

**F.** 1 face
1 vertex

**H.** 6 faces
8 vertices

**G.** 2 faces
0 vertices

---

**Identify each shape. Circle the name.**
**Write the number of faces and vertices.**

cylinder cone

_____faces _____vertices

---

Which shape has 1 face and 1 vertex?

**A.** 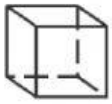

**C.**

**B.** 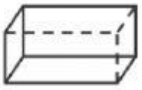

**D.**

**Identify each shape. Circle the name.**
**Write the number of faces and vertices.**

cube rectangular prism

_____faces _____vertices