Individual Task-1 (30.06.2020) Polygons (on LMS).

Instructions: Complete all the tasks.

Post your answers on LMS.

Find the value of x.

1)

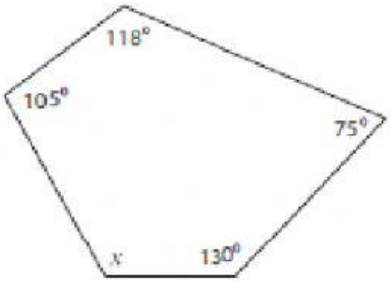

Sum of the interior angles = _____

x = _____

2)

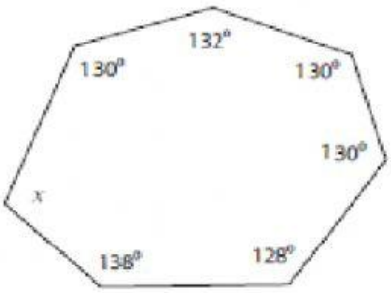

Sum of the interior angles = _____

x = _____

3)

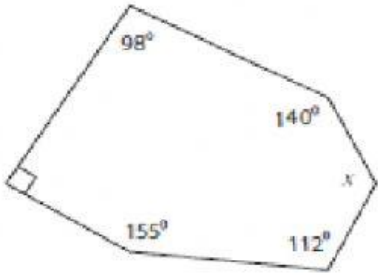

Sum of the interior angles = _____

x = _____

4)

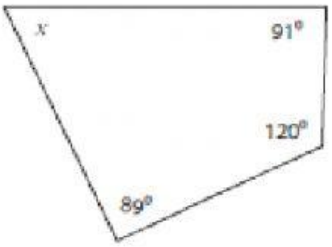

Sum of the interior angles = _____

x = _____

5)

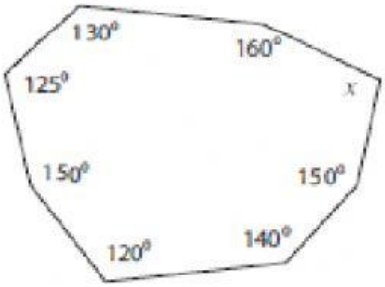

Sum of the interior angles = _____

x = _____

6)

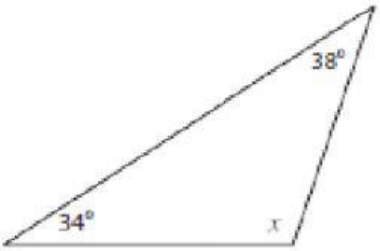

Sum of the interior angles = _____

x = _____