Tina made a new shape by putting 3 triangles together. What shape did she make?

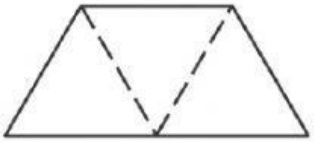

A. rectangle
B. trapezoid
C. circle

What two shapes were used to make this rectangle?

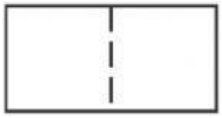

F. two triangles
G. two squares
H. two trapezoids

How many equal parts make up the whole?

F. 4 **G.** 3 **H.** 2

Circle the two shapes that were used to make this rectangle.

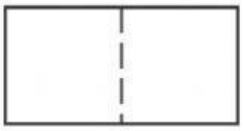

two trapezoids

two squares

Carlos put together the three shapes shown. Circle the new shape he made.

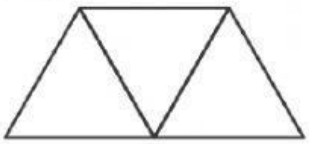

trapezoid circle

How many parts are shaded?

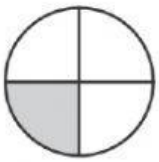

_____of _____parts

Circle the two shapes that were used to make this square.

two triangles

two rectangles

Hannah joined two shapes. She made the following shape. Circle the two shapes Hannah joined together.

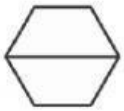

two triangles

two trapezoids
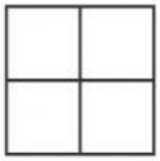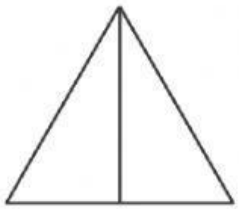
Circle the shape that shows 2 equal parts.