Посчитай, какой путь проедет автобус от начальной точки до конечной.

Для этого составь пример и реши его.

Пример:

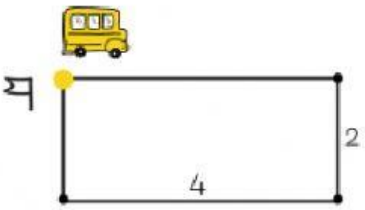

Ответ:

4+2+4+2=12

1.

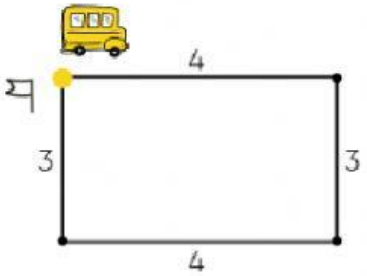

2.

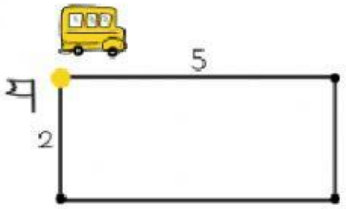

3.

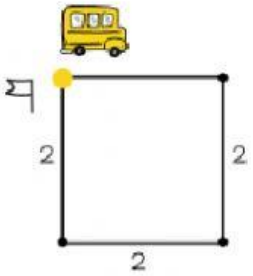
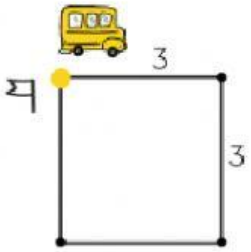
4.