Watermelon Math!

1. How many watermelon slices?



4	3	1

2. How many seeds are in this slice of watermelon?



3	2	5

3. I ate 5 slices of watermelon and my friend ate 3. How many slices did we eat altogether?



8	3	5